Name Date Time

HOME LINK 6•1

Line Segments, Rays, and Lines

Family Note Help your child match each name below with the correct drawing of a line, ray, or line segment. Then observe as your child uses a straightedge to draw and label figures. Pages 100 and 101 in the *Student Reference Book* discuss these figures.

Please return this Home Link to school tomorrow.

SRB 100 101

This line segment can be named $\overline{AB}$ or $\overline{BA}$.



Each of these rays can be named $\overrightarrow{YZ}$.



This line can be named $\overleftrightarrow{AB}$, $\overleftrightarrow{BA}$, $\overleftrightarrow{AC}$, $\overleftrightarrow{CA}$, $\overleftrightarrow{BC}$, or $\overleftrightarrow{CB}$.

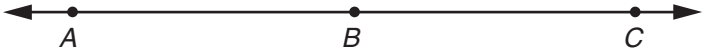

1. Match each drawing below with one of the names.

b

a. $\overline{TS}$

_____ 

b. $\overrightarrow{RS}$

_____

c. $\overleftrightarrow{TS}$

_____

d. $\overrightarrow{SR}$

_____ 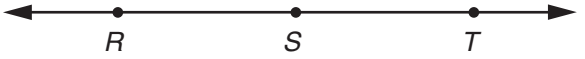

e. $\overleftrightarrow{RS}$

Follow the directions carefully. Use a straightedge.

2. Mark points *B* and *C*.
Draw a line segment, $\overline{BC}$.

3. Draw a ray, $\overrightarrow{TO}$.

Practice

Write these problems on the back of this page. Solve.

4. 479 + 89 = _____

5. 278 + 68 = _____

Copyright © Wright Group/McGraw-Hill